7 **a)** Circle all the calculations that have an answer of zero.

39 × 1 95 × 0 178 × 0

4 × 1 0 × 16

8 × 0 0 × 0 42 × 1

b) How did you work out which calculations to circle?

_____

_____

8 Eva and Mo are working out some multiplication problems.

a)

What mistake has Eva made?

_____

_____

b)



What mistake has Mo made?

_____

_____

Talk about your answers with a partner.

9 Work out these multiplications.

a) 2 × 1 = ☐

1 × 4 = ☐

2 × 4 × 1 = ☐

b) 8 × 1 = ☐

8 × 1 × 2 = ☐

8 × 1 × 3 = ☐

What pattern do you notice in each part?

Talk about it with a partner.

c) What multiplication would come next in part b)?

☐ × ☐ × ☐ = ☐

10 Eva and Dexter have 6 digit cards.

They multiply them all together.

3	4	0	9	1	2

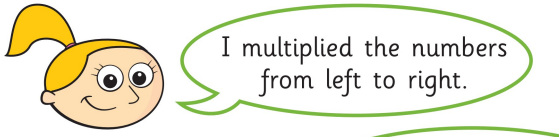

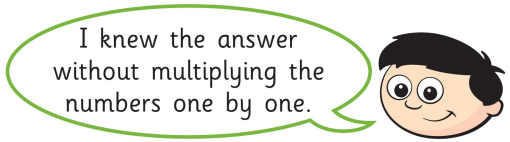

What could Dexter's method be?

Talk about it with a partner.

© White Rose Maths 2019